Nombre _____ Fecha _____ No. ☐

Escribe el número que falta en cada frase resta. Preste atención al signo =.

1	2 - 1 = ☐		16	☐ = 10 - 0	
2	1 - 1 = ☐		17	☐ = 10 - 1	
3	1 - 0 = ☐		18	☐ = 9 - 1	
4	3 - 1 = ☐		19	☐ = 7 - 1	
5	3 - 0 = ☐		20	☐ = 6 - 1	
6	4 - 0 = ☐		21	☐ = 6 - 0	
7	4 - 1 = ☐		22	☐ = 8 - 0	
8	5 - 1 = ☐		23	8 - ☐ = 8	
9	6 - 1 = ☐		24	☐ - 0 = 8	
10	6 - 0 = ☐		25	7 - ☐ = 6	
11	8 - 0 = ☐		26	7 = 7 - ☐	
12	10 - 0 = ☐		27	9 = 9 - ☐	
13	9 - 0 = ☐		28	☐ - 1 = 7	
14	9 - 1 = ☐		29	☐ - 0 = 8	
15	10 - 1 = ☐		30	9 = ☐ - 1	

EUREKA MATH™
BY-NC-SA
This work is derived from Eureka Math TM and licensed by Great Minds.
©2015 Great Minds. eureka-math.org
engage^ny

This work is derived from Eureka Math TM and licensed by Great Minds.
©2015 Great Minds. eureka-math.org

Nombre _____ Fecha _____ No. ☐

Escribe el número que falta en cada frase resta. Preste atención al signo =.

1	3 - 1 = ☐		16	☐ = 10 - 1	
2	2 - 1 = ☐		17	☐ = 9 - 1	
3	1 - 1 = ☐		18	☐ = 7 - 1	
4	1 - 0 = ☐		19	☐ = 7 - 0	
5	2 - 0 = ☐		20	☐ = 8 - 0	
6	4 - 0 = ☐		21	☐ = 10 - 0	
7	5 - 1 = ☐		22	☐ = 9 - 1	
8	7 - 1 = ☐		23	9 - ☐ = 8	
9	8 - 1 = ☐		24	☐ - 1 = 8	
10	9 - 0 = ☐		25	7 - ☐ = 6	
11	10 - 0 = ☐		26	6 = 7 - ☐	
12	7 - 0 = ☐		27	9 = 9 - ☐	
13	8 - 0 = ☐		28	☐ - 0 = 9	
14	10 - 1 = ☐		29	☐ - 0 = 10	
15	9 - 1 = ☐		30	8 = ☐ - 1	

EUREKA MATH™
BY-NC-SA
This work is derived from Eureka Math TM and licensed by Great Minds.
©2015 Great Minds. eureka-math.org
engage^ny

This work is derived from Eureka Math TM and licensed by Great Minds.
©2015 Great Minds. eureka-math.org

Nombre _____ Fecha _____

Tacha para restar.

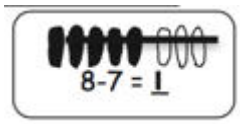

1.

6 – 6 = _____

2.

6 – 5 = _____

Resta. Haz un dibujo de matemáticas, como los de arriba, para cada ejercicio.

3.

7 – 7 = _____

4.

7 – 6 = _____

5.

10 – 10 = _____

6.

10 – 9 = _____

7.

8 – 8 = _____

8.

8 – 7 = _____

9.

9 – 9 = _____

10.

9 – 8 = _____

EUREKA MATH™
BY-NC-SA
This work is derived from Eureka Math TM and licensed by Great Minds.
©2015 Great Minds. eureka-math.org
engage^ny

This work is derived from Eureka Math TM and licensed by Great Minds.
©2015 Great Minds. eureka-math.org

Resta. Tacha, cuando sea necesario.

11.

6 – 6 = ___

12.

8 – 8 = ___

13.

9 – 8 = ___

Resta. Haz un dibujo de matemáticas, como los de arriba, para cada ejercicio.

14.

15.

16.

7 – 7 = _____

8 – 7 = _____

9 – 9 = _____

Completa el número que falta. Imagina tus grupos de 5 para ayudarte.

a. 6 – 6 = _____

b. 6 – 5 = _____

c. 7 - _____= 0

d. 7 - 6 = _____

e. 8 – 8 = _____

f. 8 - _____ = 1

g. 9 – _____ = 0

h. 9 – 8 = _____

i. 10 – _____ = 10

j. 10 – _____ = 1

EUREKA MATH™

BY-NC-SA

This work is derived from Eureka Math TM and licensed by Great Minds.
©2015 Great Minds. eureka-math.org

engage^ny

Nombre _____ Fecha _____

Haz dibujos de grupos de 5 para mostrar la resta.

1.

9 – ___ = 1

2.

0 = 10 – ___

3.

1 = ___ – 7

4.

0 = ___ – 9

EUREKA MATH™

BY-NC-SA

This work is derived from Eureka Math TM and licensed by Great Minds.
©2015 Great Minds. eureka-math.org

engage^ny

This work is derived from Eureka Math TM and licensed by Great Minds.
©2015 Great Minds. eureka-math.org

Nombre _____ Fecha _____

Tacha para restar.

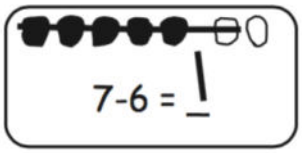

1.

2.

10 – 10 = _____ 9 – 8 = _____

Haz un dibujo de grupos de 5, como los de arriba. Muestra la resta.

3.

1 = _____ - 7

4.

8 - _____ = 0

5.

0 = _____ - 7

6.

6 - _____ = 1

Haz un dibujo de grupos de 5 como el modelo para cada problema. Muestra la resta.

EUREKA MATH™
BY-NC-SA
This work is derived from Eureka Math TM and licensed by Great Minds.
©2015 Great Minds. eureka-math.org
engage^ny

7.

8.

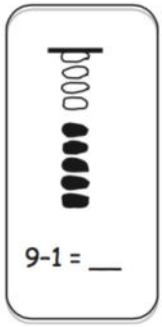

9 -_____= 1

0 = 8 - _____

EUREKA MATH™

BY-NC-SA

This work is derived from Eureka Math TM and licensed by Great Minds.
©2015 Great Minds. eureka-math.org

engage^ny

Escribe la oración numérica de resta para igualar con el dibujo de grupo de 5.

9.

_____ - _____ = _____

10.

_____ - _____ = _____

11.

_____ - _____ = _____

12.

_____ - _____ = _____

13.

_____ - _____ = _____

Completa el número que falta. Imagina tus grupos de 5 para ayudarte.

(a) 7 - _____= 0

(b) 1 = 7 - _____

(c) 8 - _____=

(d) 6 - _____ = 0

(e) 0 = 9 - _____

(f) 1 = 10 - _____

(g) 10 - _____= 0

(h) 9- _____= 1

EUREKA MATH™

BY-NC-SA

This work is derived from Eureka Math TM and licensed by Great Minds.
©2015 Great Minds. eureka-math.org

engage^ny

This work is derived from Eureka Math TM and licensed by Great Minds.
©2015 Great Minds. eureka-math.org